BASIC RIGHT TRIANGLE TRIGONOMETRY WORKSHEET

Solve the below problems

1. 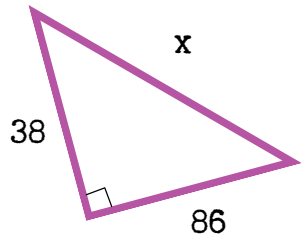

x = _____

2. 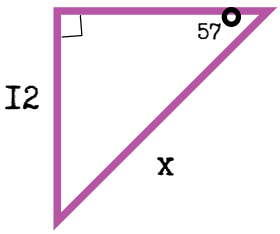

x = _____

3. 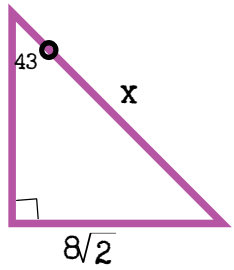

x = _____

4. 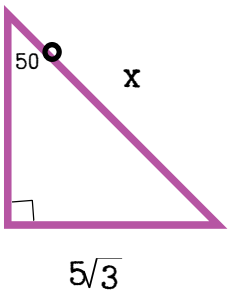

x = _____

5. 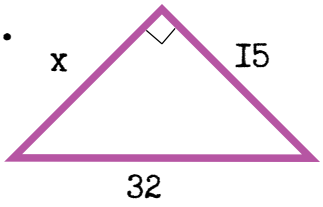

x = _____

6. 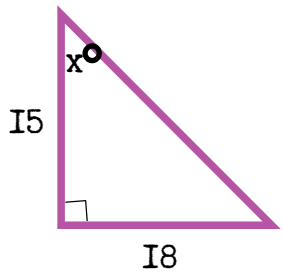

x = _____

7. 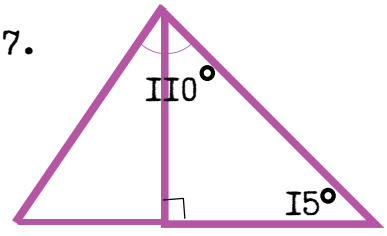

x = _____

8. 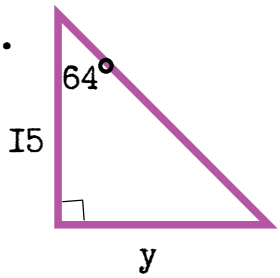

x = _____

9. 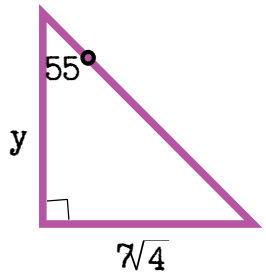

x = _____